Completing and Matching Volume Equations

Name:

Match each problem with the equation that could represent it. Answer with the missing term and letter.

Ex) 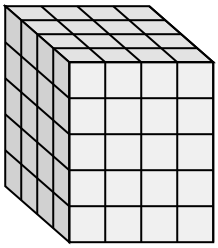

1) 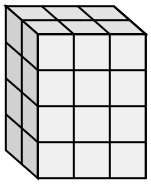

2) 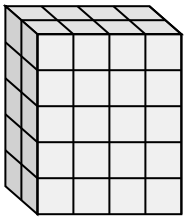

3) 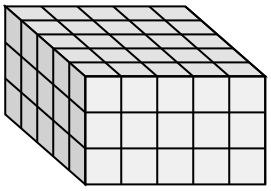

4) 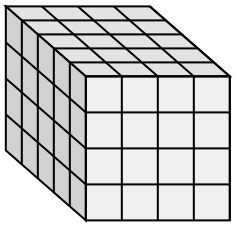

5) 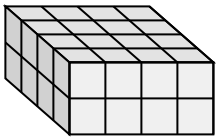

6) 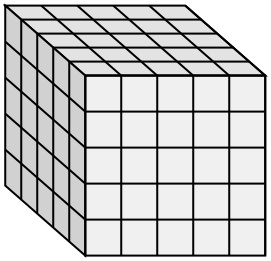

7) 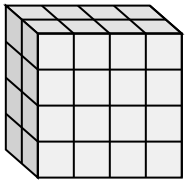

8) 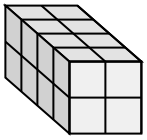

9) 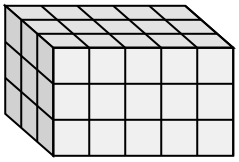

10) 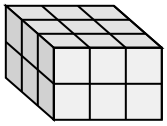

11) 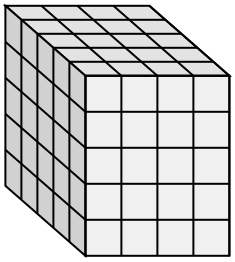

A) 5 × ___ × 5 = 125

B) 4 × ___ × 2 = 16

C) ___ × 4 × 2 = 32

D) ___ × 3 × 4 = 24

E) 5 × ___ × 3 = 75

F) 5 × 4 × ___ = 80

G) 2 × 4 × 5 = ___

H) 3 × ___ × 3 = 45

I) 3 × 3 × 2 = ___

J) 2 × ___ × 4 = 32

K) ___ × 4 × 5 = 100

L) 4 × 4 × ___ = 80

Answers

Ex. L , 5

1. _____
2. _____
3. _____
4. _____
5. _____
6. _____
7. _____
8. _____
9. _____
10. _____
11. _____

Completing and Matching Volume Equations Name: **Answer Key**

Match each problem with the equation that could represent it. Answer with the missing term and letter.

Ex) 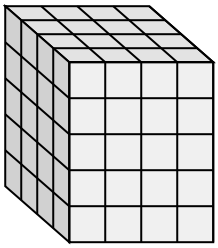

1) 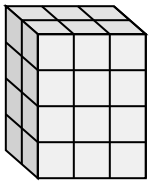

2) 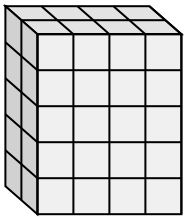

3) 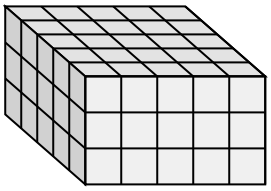

4) 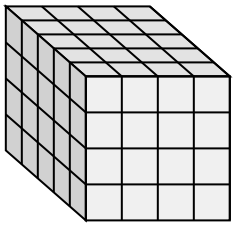

5) 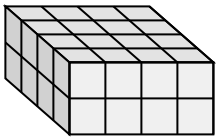

6) 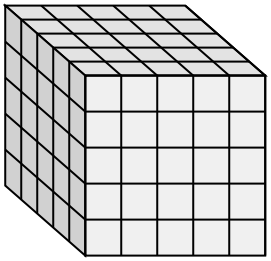

7) 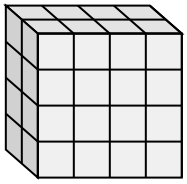

8) 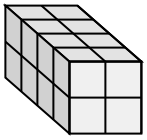

9) 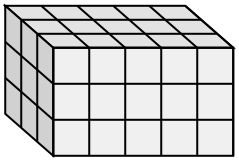

10) 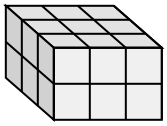

11) 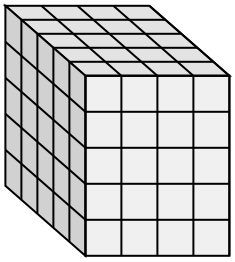

A) 5 × ___ × 5 = 125

B) 4 × ___ × 2 = 16

C) ___ × 4 × 2 = 32

D) ___ × 3 × 4 = 24

E) 5 × ___ × 3 = 75

F) 5 × 4 × ___ = 80

G) 2 × 4 × 5 = ___

H) 3 × ___ × 3 = 45

I) 3 × 3 × 2 = ___

J) 2 × ___ × 4 = 32

K) ___ × 4 × 5 = 100

L) 4 × 4 × ___ = 80

Answers

Ex.	L , 5
1.	D , 2
2.	G , 40
3.	E , 5
4.	F , 4
5.	C , 4
6.	A , 5
7.	J , 4
8.	B , 2
9.	H , 5
10.	I , 18
11.	K , 5